Name _____ Date _____ Period _____

Warm Up 1.2b: Analyzing Graphs

1. Identify whether each of the relations below is a function or non-function and find its domain and range.

F/nF? _____

a.

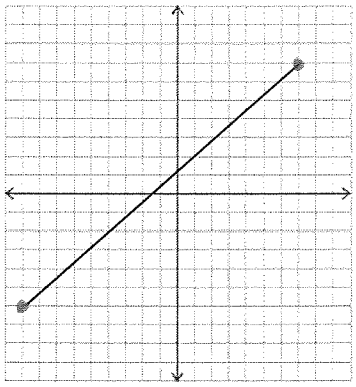

Domain: _____

Range: _____

F/nF? _____

b.

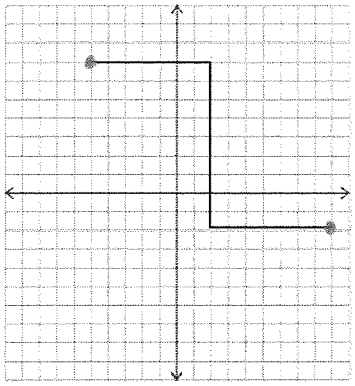

Domain: _____

Range: _____

F/nF? _____

c.

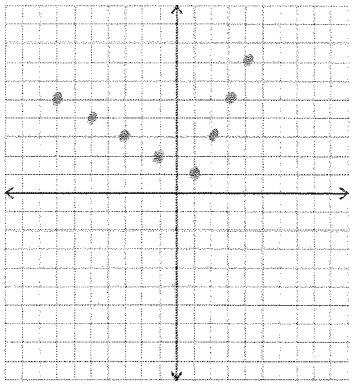

Domain: _____

Range: _____

2. Identify whether each of the relations below is Continuous or Discrete.

C/D? _____

a.

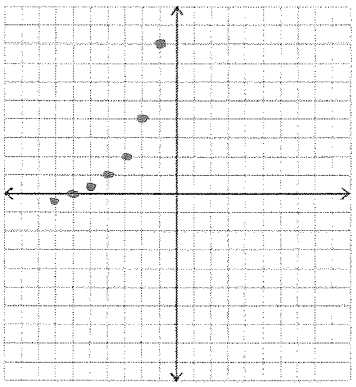

C/D? _____

b.

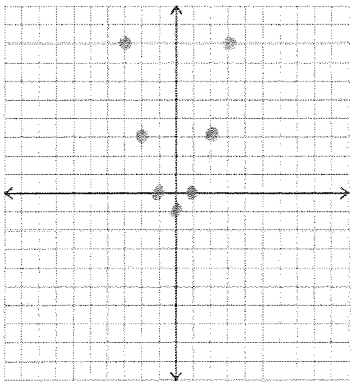

C/D? _____

c.

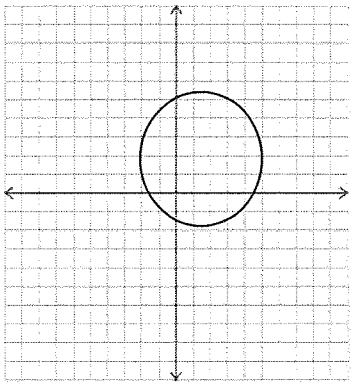

3. Sketch the graph of a relation that is an example of a discrete non-function.